English – Day Four

Characters

This book is all about a boy who finds a new world filled with Tree Goblins but did you know that there are lots of different types of goblins in the world? When you write your story, your character could meet a different type of goblin.

* Let's make a list of the goblins that could be in your story. To help create a goblin I like to use weather, nature or places to help me but you may have your own amazing ideas.

* Record your ideas for different types of Goblins here – I have started you off with some names:

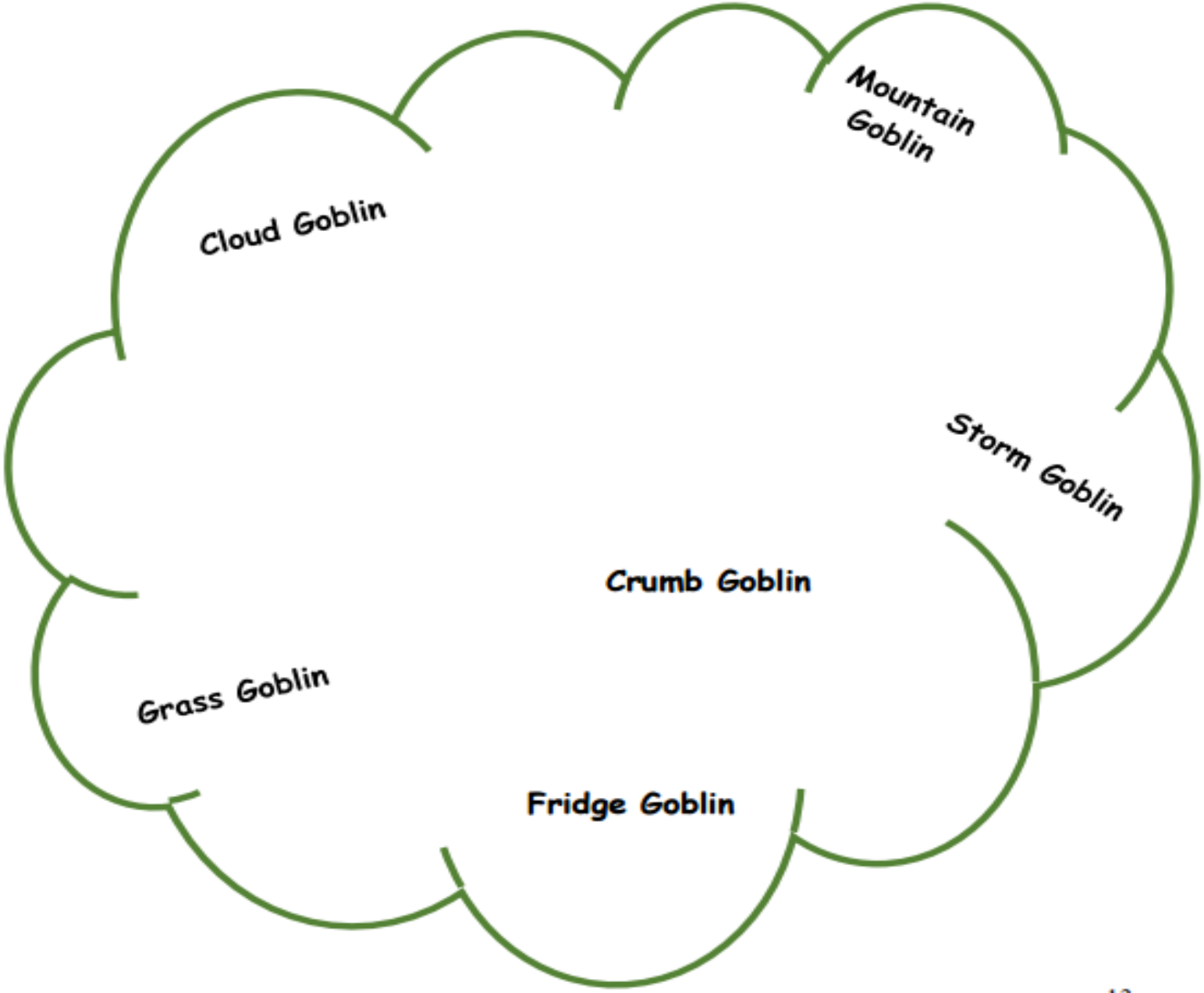
Mountain Goblin
Cloud Goblin
Storm Goblin
Crumb Goblin
Grass Goblin
Fridge Goblin

Now choose 3 of your favourite ideas and draw the goblins in the picture frames below. Can you write 5 facts that everyone should know about them? I have done an example using the Tree Goblins for you.



5 Tree Goblin Key Facts

1) Tree Goblins can only be found in evergreen trees (trees that do not lose their leaves in winter). The bigger the tree that they live in, the bigger the goblin that lives there.
2) Tree Goblins are vegetarian.
3) They do not get on with Bog Goblins – for centuries they have been arch enemies.
4) Tree Goblins can sleep for up to 14 hours a day and snore loudly.
5) They are not good pets due to their untidiness but they are very friendly.

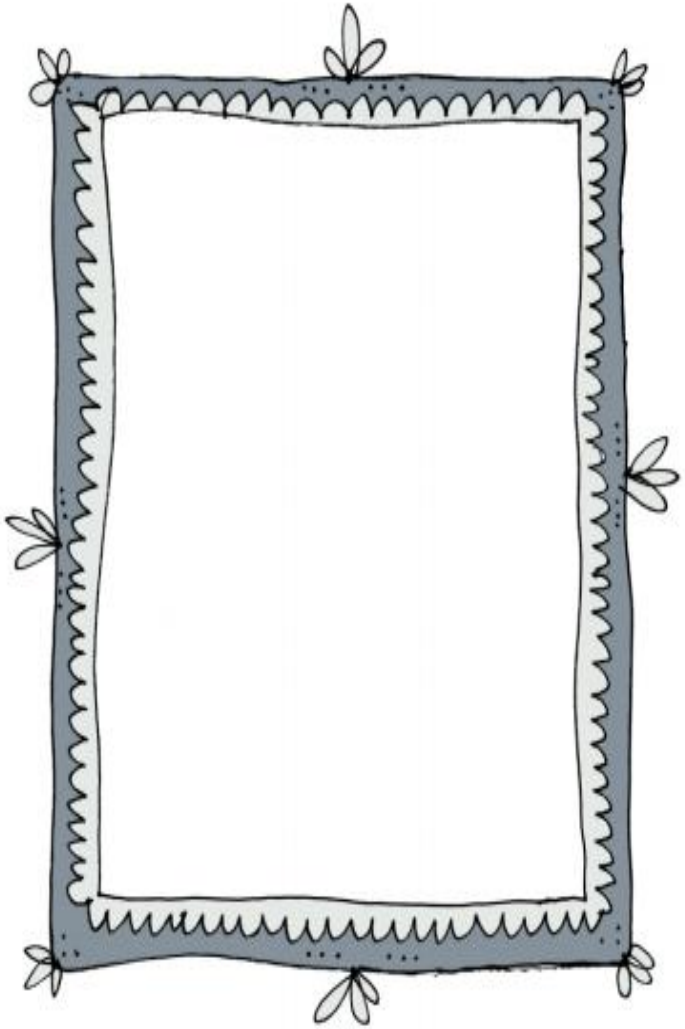

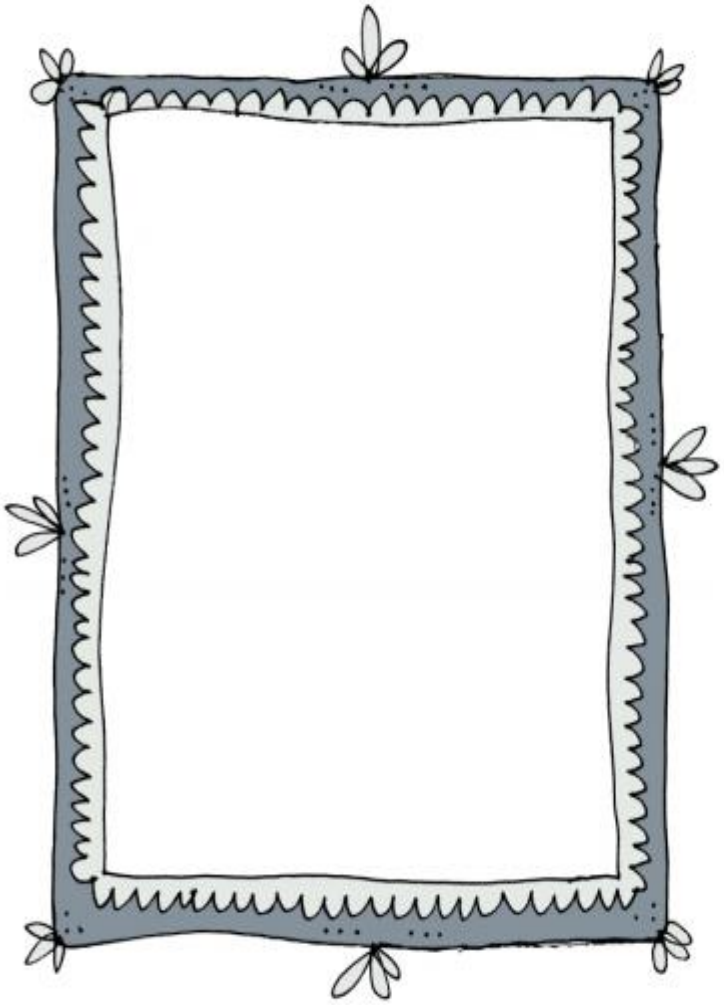

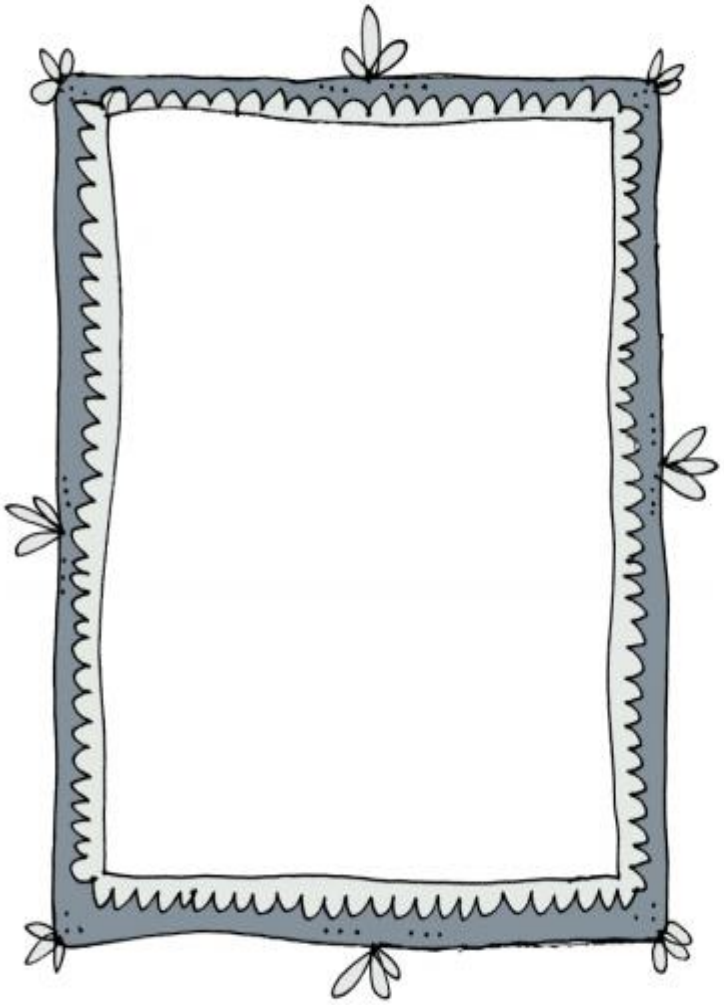

Thursday 18th June 2020 - WALT: Use charts and tables continued – Practice Questions.

Charts and tables 2

1

Each represents 6 marbles.

Number of marbles won in December	
Tom	
Alice	
Otis	
Gracie	

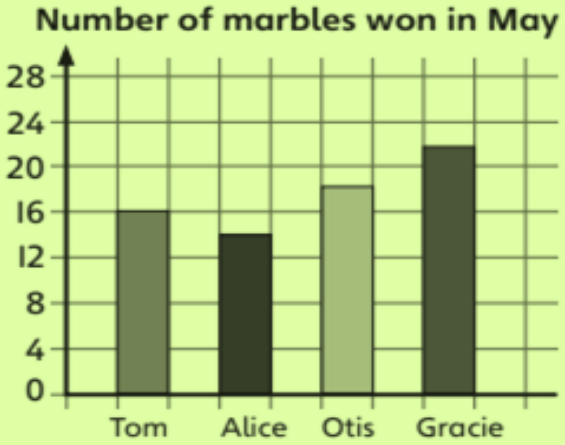

a) How many marbles did Alice win in December and May altogether?

☐ + ☐ = ☐

Alice won ☐ marbles in December and May.

b) How many more marbles did Otis win in May compared to Alice?

Otis won ☐ marbles in May.

Alice won ☐ marbles in May.

☐ – ☐ = ☐

Otis won ☐ more marbles in May than Alice.

c) How many marbles did the children win in May altogether?

2 This table shows the number of visitors to the History Museum and the Science Museum over three days.

Complete the table.

Number of visitors

	History Museum	Science Museum	Total
Saturday	625		1,425
Sunday	745	725	
Monday		390	780

3 Tom and Sarah are playing video games. Use the information below to complete the table, then complete a bar chart showing the scores for Sarah.

Sarah scored 450 more on Vault Explorer than Tom.

Tom scored 250 more on Climbing Road than he did on Space Raiders.

Number of points earned

	Space Raiders	Vault Explorer	Climbing Road
Sarah	700		850
Tom	550	200	

Number of points scored by Sarah

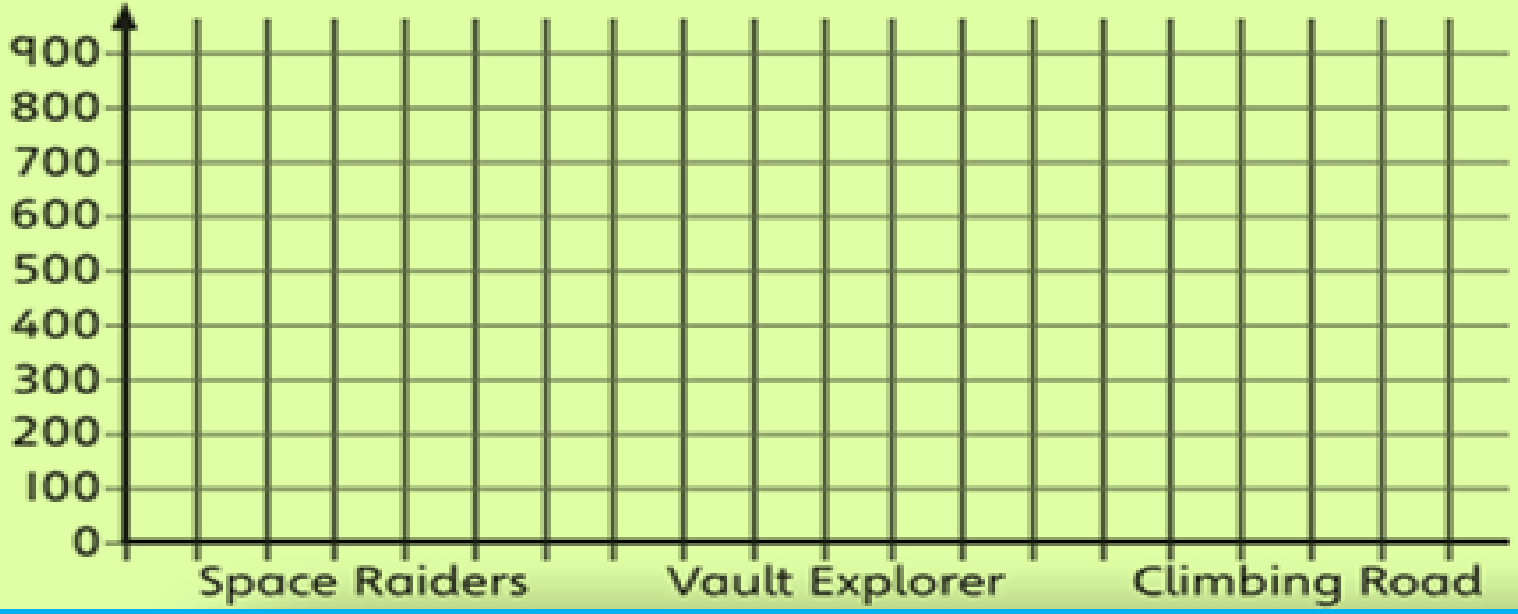

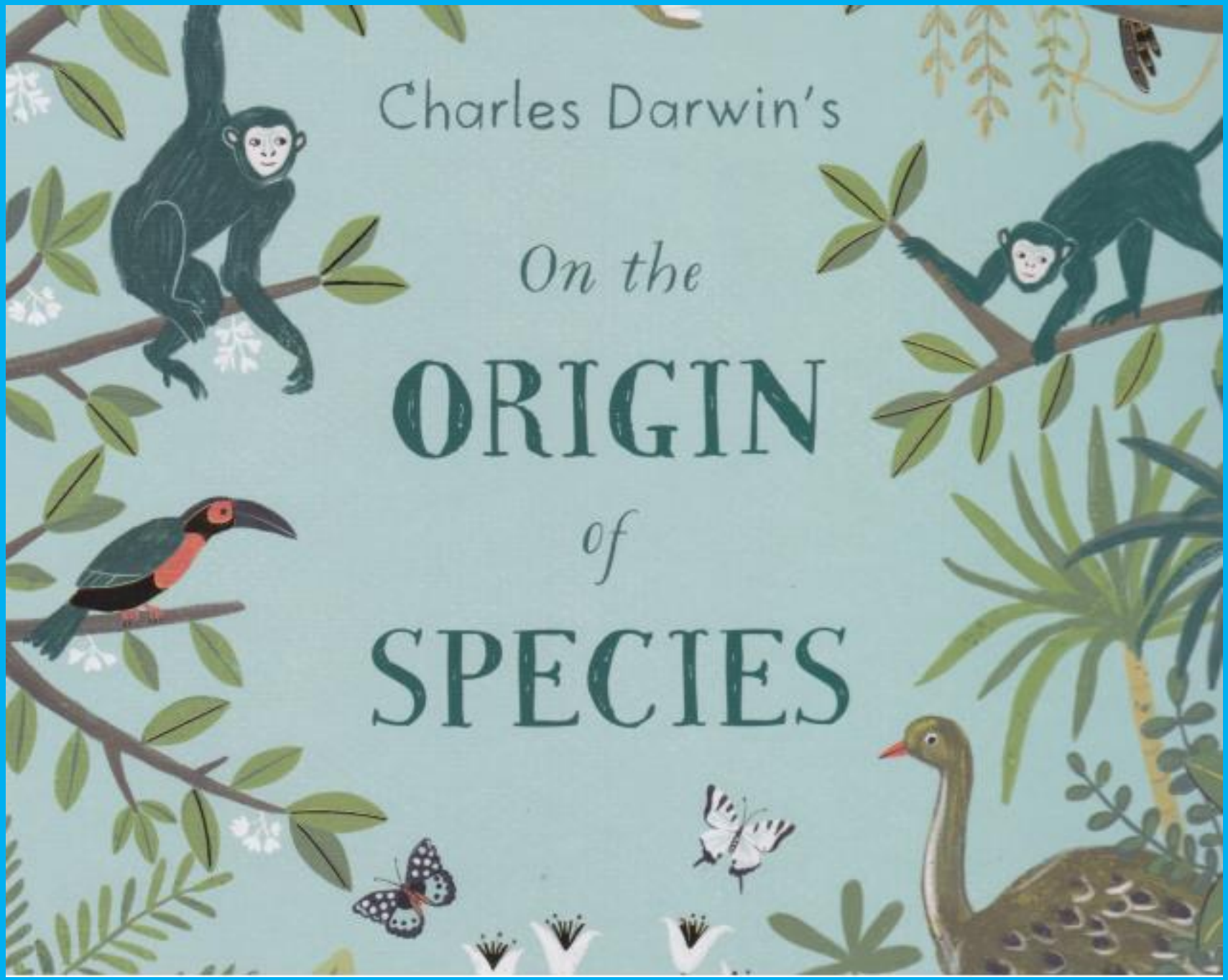
Charles Darwin's
On the
ORIGIN
of
SPECIES

What is happening in the image below? What is a threat to the yellow smooth peach? Which peach is more likely to survive because it is better adapted to its environment? Imagine this is the first panel of a storyboard. Draw the next panel based on what you have learned about Natural Selection. Give reasons for your choices.

1

2

Outdoor Home Learning

Open the link to investigate this further…

Birdy Surveys

Birds are an easy group to watch whether you're indoors or out. Grab some binoculars or make your own just for show and survey what you can see, same time each day. Can you see any patterns emerging?

https://www.ltl.org.uk/resources/birdysurveys/