Guided Reading

If you would like to read "The Week Junior" newspaper as your daily reading, please follow this link:
https://www.yumpu.com/en/document/read/63174530/theweekjunior-224-2703-schools

Complete the coloured work labelled on your pack.

If you want a challenge, or have some extra time, please feel free to try another group's work ☺

Purple Group complete page 13 in your work book.

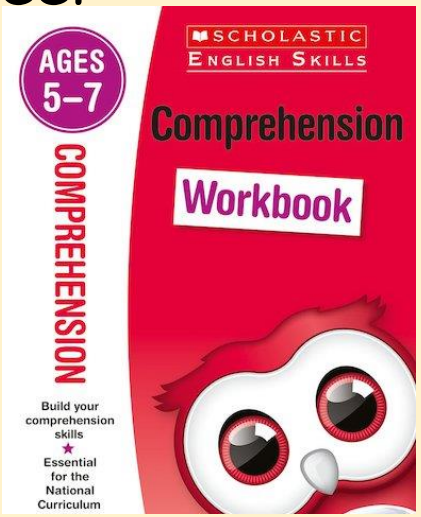

Inference

Why is the helicopter flying towards the boat?
Who do you think is in the helicopter?
How might the people on the boat be feeling?
What impact is the weather having on this scene?

twinkl.co.uk

Photo courtesy of (Defence Images@flickr.com) - granted under creative commons licence - attribution

Handwriting

Complete page 7 in your handwriting book.



English

This week we will write our own poems using poetic techniques

Poems with structure

In the ocean of dreams I saw…
Three friendly dolphins
Playing in the sun.

In the ocean of dreams I saw…
Six sneaky starfish
Shuffling across the sea bed.

In the ocean of dreams I saw…
Four fishing trawlers
Dredging the frothy waves.

In the racetrack of champions I heard…
Three aggressive engines
Warming up at the start line.

In the racetrack of champions I heard …
Twelve squeaky tyres
Burning rubber marks on the track.

In the racetrack of champions I heard …
Thousands of cheering spectators
Engrossed in the rapid race.

What do you notice about these poems?

In the ocean of dreams I saw…
Three friendly dolphins
Playing in the sun.

In the ocean of dreams I saw…
Six sneaky starfish
Shuffling across the sea bed.

In the ocean of dreams I saw…
Four fishing trawlers
Dredging the frothy waves.

adjective

noun

number

What it is doing?

Can you find the same features in the first two verses?

In the racetrack of champions I heard…
Three aggressive engines
Warming up at the start line.

In the racetrack of champions I heard …
Twelve squeaky tyres
Burning rubber marks on the track.

In the racetrack of champions I heard …
Thousands of cheering spectators
Engrossed in the rapid race.

Can you find any similar features in this poem?

Make a list of them all.

Maths

Year 3

Complete the coloured work you would normally do in class.

If you want a challenge, or have some extra time, please feel free to try another group's work ☺

Red Group to follow this link - https://REJESEY.exampro.net

Purple group – complete page 11 of your workbook

We are recapping our knowledge of adding.

How quickly can you recall your number bonds to 10?

Blue group - complete page 11 of your workbook

We are recapping our knowledge of odd and even.

Write down how to find out if a number is odd or even.
Can you use pictures to illustrate how you know?

WALT: find 1, 10 and 100 more and less.

We are going to consolidate our knowledge of place value, which we looked at in Autumn Term.

Look at the yellow pages to help you, then complete the work for your group.

Green group – green background

Orange group – orange background

Discover

1 **a)** How many points does Amal have?

Amal receives 100 more.

How many points does he have now?

Share

I can represent the notes using base 10 equipment.

a)

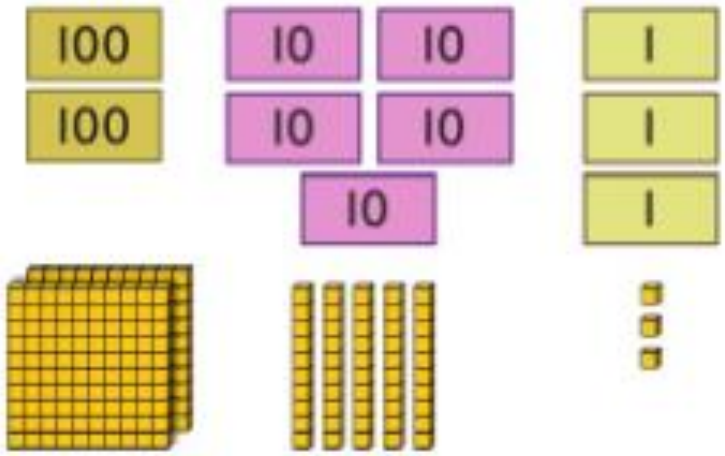

Amal has 253 points.



He receives 100 more.

100 more than 253 is 353.

Amal now has 353 points.

Discover

b) Holly has 204 points.

She loses 10 points.

How many points does she have now?

Holly has 204 points and loses 10.

H	T	O
		
2	0	4

H	T	O
		
1	9	4

I don't have any 10s.
I need to **exchange**
1 hundred for 10 tens.

10 less than 204 is 194.

Holly now has 194 points.

Complete the sentences.

a) 10 less than

H	T	O
1	2	6

is ☐.

b) 100 more than

H	T	O
7	0	3

is ☐.

c) 10 more than 918 is ☐.

d) 100 more than 755 is ☐.

e) 1 less than 79 is ☐.

f) 100 less than ☐ is 289.

g) 10 less than ☐ is 718.

h) 1 more than ☐ is 115.

CHALLENGE

4 Kate is working out 10 more than 195 .

H	T	O
1	9	5

I think the answer is 1105.

Kate

Ebo is solving the problem in the box.

The answer is 557.

Ebo

457 is 100 more than

_____

What mistake has each of them made?

I can check Ebo's answer and see if the sentence is true.

I think Kate needs to exchange some 10s for 100.

Mary has the number 700.



a) Complete the table for Mary's number.

100 more	100 less	10 more	10 less	1 more	1 less

b) Mo did the same for his number. What number did Mo have?

100 more	100 less	10 more	10 less	1 more	1 less
598		508			

Mo had the number ☐.

Can you get from Start to Finish on this board?

You can only move one square at a time and go up, down, left or right.

Start 120	10 more	100 more	1 more
10 more	1 less	1 less	10 more
100 more	10 less	10 less	10 less
100 less	100 more	**Finish 309**	100 more

Topic – Climate Change

WALT: understand different types of renewable energy.

What types of renewable energy are there?

- https://www.bbc.co.uk/bitesize/topics/zshp34j/articles/zntxgwx

Watch the video and make a list of all of the renewable energy you have heard about



Pick a renewable energy source and research the benefits of it.

As a challenge research more than one and compare the benefits.

Draw a picture of the energy source you have chosen and mind map notes in your books.

Physical activity – minimum 30 minutes each day	Link to resource
5 a day User Name: FPS53 / Password: JFz4XqG7	https://player.5-a-day.tv/
Joe Wicks – PE sessions	https://www.youtube.com/channel/UCAxW1XT0iEJo0TYlRfn6rYQ
Cosmic Kids Yoga	https://www.youtube.com/user/CosmicKidsYoga
PE Hub Parents Portal	https://pehubportal.co.uk/
Go Noodle	https://www.gonoodle.com/good-energy-at-home-kids-games-and-videos/
Go for a walk/run. You must go with an adult from your home and make sure you stay 2 metres away from other people.	